Garden Problem

Monitoring Table

Strategy	Who and What	Order	Connections
$2(n+2)+2$ 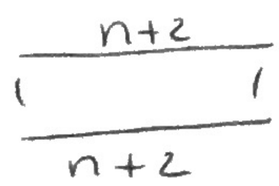	Deann	3	How are the corners and side tiles accounted
$2(n+3)$ 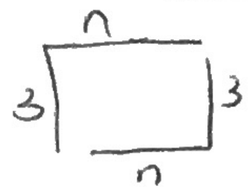	Chris	4	for in each of these ~~equ~~ statements?
$n+3+n+3$ 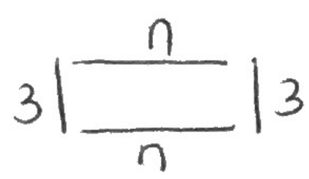 $2n+6$	Rhonda Rusty	1 2	How are these similar and how are they ~~the same~~ different?
$3(n+2)-n$ 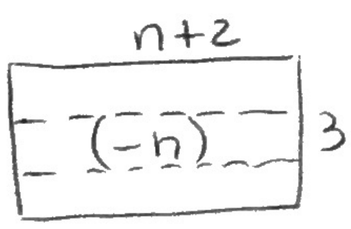	Julia	5	What is different about this ~~meto~~ method compared the the first four presented?
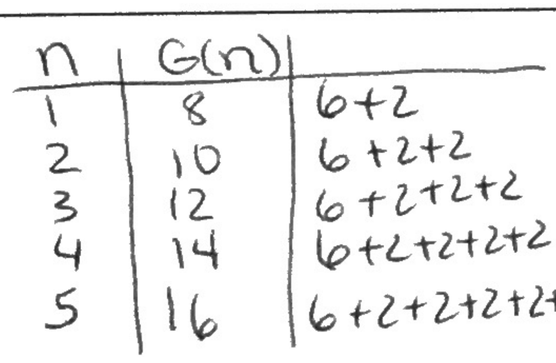	Ted + Susan	6	Where is the 2 in the table
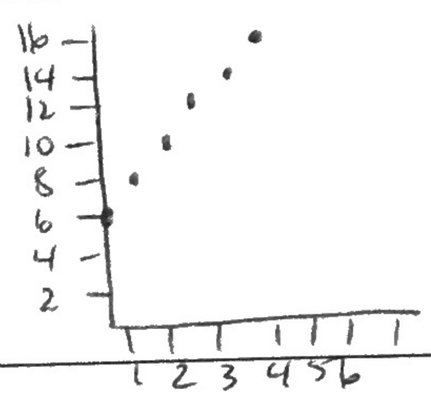	David	7	and graph? Describe the 0 garden.
other			